Name: _____

Sr: 16052023-3121

May 16, 2023

MATHS WORKSHEET GENERATOR 11-PLUS SATS GCSES

1) 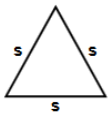

Find perimeter of triangle s = 37 m

Answer: _____

2) 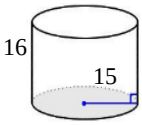

Find Volume of Cylinder

Answer: _____

3) 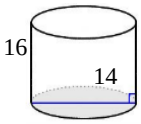

Find Volume of Cylinder

Answer: _____

4) 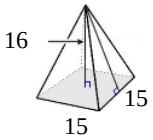

Find Volume of Square Pyramid

Answer: _____

5) 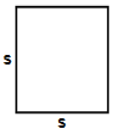

Find area of square having each side (s) equals 35 cm

Answer: _____

6) 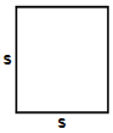

Find perimeter of square having each side (s) equals 92 in

Answer: _____

7) 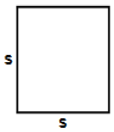

Find perimeter of square having each side (s) equals 32 in

Answer: _____

8) 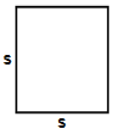

Find perimeter of square having each side (s) equals 33 cm

Answer: _____

9) 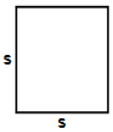

Find area of square having each side (s) equals 28 cm

Answer: _____

10) 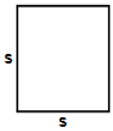

Find area of square having each side (s) equals 43 m

Answer: _____

11) 

Find area of square having each side (s) equals 40 in

Answer: _____

12) 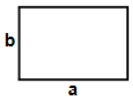

Find perimeter of rectangle having sides a = 75 ft and b = 44 ft

Answer: _____

13) 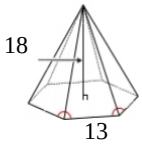

Find Volume of Hexagonal Pyramid

Answer: _____

14) 

Find perimeter of square having each side (s) equals 69 cm

Answer: _____

15) 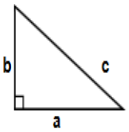

Find area of triangle a = 56 ft, b = 87 ft

Answer: _____

Copyright 2023 - Geek School Tutoring Limited

Name: _____

Sr: 16052023-3121

May 16, 2023

16)

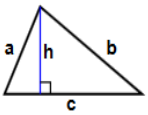

Find perimeter of triangle
h = 51 , a = 77 in,
b = 87 in, c = 98in

Answer: _____

17)

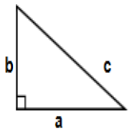

Find perimeter of triangle
a = 87 cm, b = 97 cm,
c = 99cm

Answer: _____

18)

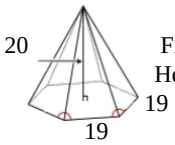

Find Volume of Hexagonal Pyramid

Answer: _____

19)

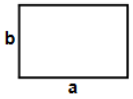

Find area of rectangle having sides a = 99 cm and b = 89 cm

Answer: _____

20)

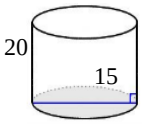

Find Volume of Cylinder

Answer: _____

Total: ___ / 20

Copyright 2023 - Geek School Tutoring Limited

Name: _____

Sr: 16052023-3121

May 16, 2023

Answers:

1) 111m	2) 11309.733552923	3) 2463.0086404144	4) 1200	5) 1225cm	6) 368in	7) 128in
8) 132cm	9) 784cm	10) 1849m	11) 1600in	12) 238ft	13) 2634.4492783123	14) 276cm
15) 2436ft	16) 262in	17) 283cm	18) 6252.7034153236	19) 8811cm	20) 3534.2917352885	

Copyright 2023 - Geek School Tutoring Limited